StudySite.org
StudySite.org

Test Booklet Code **A**

Test Booklet Sr. No.: 10296

TEST PAPER *(JEE)*

Marks: 100

Time: 01 hour 30 minute

ROLL NO.: 31030449	NAME: Arundeep Singh
SIGNATURE:	DATE / TIME: 31/3/12 2:17 pm

INSTRUCTIONS FOR THE CANDIDATES

1	Before attempting the paper carefully read out all the Instructions & Examples given on Side 1 of Answer Sheet (OMR Sheet) supplied separately.
2	At the start of the examination, please ensure that all pages of your Test booklet are properly printed; your Test booklet is not damaged in any manner and contains **100 questions (General knowledge 1-40 & Technical 61 to 100)** In case of any discrepancy the candidate should immediately report the matter to the invigilator for replacement of Test Booklet. No claim in this regard will be entertained at the later stage.
3	An **OMR Answer Sheet** is being provided separately along with this Test booklet. Please fill up all relevant entries like Roll Number, Test Booklet Code etc. in the spaces provided on the OMR Answer Sheet and put your signature in the box provided for this purpose.
4	Make sure to fill the correct Test booklet code on Side 2 of the OMR Answer Sheet. If the space for the Booklet Code is left blank or more than one booklet code is indicated therein, it will be deemed to be an incorrect booklet code & Answer Sheet will not be evaluated. The candidate himself/herself will be solely responsible for all the consequences arising out of any error or omission in writing the test booklet code.
5	**This Test Booklet consists of 8 pages containing 100 questions (General knowledge 1-40 & Technical 61 to 100).** Against each question four alternative choices (1), (2), (3), (4) are given, out of which one is correct. Indicate your choice of answer by darkening the suitable circle with **BLACK/BLUE pen** in the OMR Answer Sheet supplied to you separately. **Note:** In case you feel there is more than one correct answer, choose the best one.
6	The maximum marks are **100**. Each question carries 1 mark each. Candidate will be awarded one mark each for correct answer and *0.25 (1/4) mark* each will be deducted for *incorrect answer. No deduction* will be made if *no answer* is indicated. More than one answer indicated against a question will be deemed as incorrect response and will be negatively marked.
7	Do not fold or make any stray marks on the OMR Answer Sheet. Any stray mark or smudge on the OMR Answer Sheet may be taken as wrong answer. Any damage to OMR Answer Sheet may result in disqualification of the candidate.
8	On completion of the test, candidate must hand over the OMR Answer Sheet to the invigilator on duty in the room/hall.
9	Use of Mobile phones and calculators etc. are not allowed.
10	Keep all your belongings outside the Examination hall. Do not retain any paper except the ADMIT CARD.

StudySite.org
StudySite.org

StudySite.org

Q. No	Question
1	The length of the bridge, which a train 130 metres long and travelling at 45 km/hr can cross in 30 seconds, is: (1) 200 m (2) 225 m (3) 245 m (4) 250 m
2	4 men and 6 women can complete a work in 8 days, while 3 men and 7 women can complete it in 10 days. In how many days will 10 women complete it? (1) 35 (2) 40 (3) 45 (4) 50
3	In a certain store, the profit is 320% of the cost. If the cost increases by 25% but the selling price remains constant, approximately what percentage of the selling price is the profit? (1) 30% (2) 70% (3) 100% (4) 250%
4	The sum of ages of 5 children born at the intervals of 3 years each is 50 years. What is the age of the youngest child? (1) 4 years (2) 8 years (3) 10 years (4) None of these
5	The average weight of 8 person's increases by 2.5 kg when a new person comes in place of one of them weighing 65 kg. What might be the weight of the new person? (1) 76 kg (2) 76.5 kg (3) 85 kg (4) Data inadequate
6	Find the greatest number that will divide 43, 91 and 183 so as to leave the same remainder in each case. (1) 4 (2) 7 (3) 9 (4) 13
7	3 pumps, working 8 hours a day, can empty a tank in 2 days. How many hours a day must 4 pumps work to empty the tank in 1 day? (1) 9 (2) 10 (3) 11 (4) 12
8	A train can travel 50% faster than a car. Both start from point A at the same time and reach point B 75 kms away from A at the same time. On the way, however, the train lost about 12.5 minutes while stopping at the stations. The speed of the car is: (1) 100 kmph (2) 110 kmph (3) 120 kmph (4) 130 kmph
9	The ratio between the perimeter and the breadth of a rectangle is 5 : 1. If the area of the rectangle is 216 sq. cm, what is the length of the rectangle? (1) 16 cm (2) 18 cm (3) 24 cm (4) Data inadequate
10	What least number must be added to 1056, so that the sum is completely divisible by 23? (1) 2 (2) 3 (3) 18 (4) 21
11	Find the odd one out. 6, 9, 15, 21, 24, 28, 30 (1) 28 (2) 21 (3) 24 (4) 30
12	From a point P on a level ground, the angle of elevation of the top tower is 30°. If the tower is 100 m high, the distance of point P from the foot of the tower is: (1) 149 m (2) 156 m (3) 173 m (4) 200 m
13	An accurate clock shows 8 o'clock in the morning. Through how may degrees will the hour hand rotate when the clock shows 2 o'clock in the afternoon? (1) 144° (2) 150° (3) 168° (4) 180°
14	Three times the first of three consecutive odd integers is 3 more than twice the third. The third integer is: (1) 9 (2) 11 (3) 13 (4) 15
15	What was the day of the week on 17th June, 1998? (1) Monday (2) Tuesday (3) Wednesday (4) Thursday
16	A sum fetched a total simple interest of Rs. 4016.25 at the rate of 9 p.c.p.a. in 5 years. What is the sum? (1) Rs. 4462.50 (2) Rs. 8032.50 (3) Rs. 8900 (4) Rs. 8925
17	The difference between simple and compound interests compounded annually on a certain sum of money for 2 years at 4% per annum is Re. 1. The sum (in Rs.) is: (1) 625 (2) 630 (3) 640 (4) 650

StudySite.org StudySite.org

StudySite.org
StudySite.org

18	In a shower, 5 cm of rain falls. The volume of water that falls on 1.5 hectares of ground is: (1) 75 cu. M (2) 750 cu. M (3) 7500 cu. M (4) 75000 cu. M
19	Two numbers are respectively 20% and 50% more than a third number. The ratio of the two numbers is: (1) 2 : 5 (2) 3 : 5 (3) 4 : 5 (4) 6 : 7
20	There are two examinations rooms A and B. If 10 students are sent from A to B, then the number of students in each room is the same. If 20 candidates are sent from B to A, then the number of students in A is double the number of students in B. The number of students in room A is: (1) 20 (2) 80 (3) 100 (4) 200
21	Look at this series: 3, 4, 7, 8, 11, 12, ... What number should come next? (1) 7 (2) 10 (3) 14 (4) 15
22	Look at this series: 544, 509, 474, 439, ... What number should come next? (1) 404 (2) 414 (3) 420 (4) 445
23	In these series, you will be looking at both the letter pattern & the number pattern. Fill the blank in the middle of the series or end of the series. CMM, EOO, GQQ, IS, KUU (1) GRR (2) GSS (3) ISS (4) ITT
24	Choose the correct alternative that will continue the same pattern and replace the question mark in the given series. *3, 10, 101,?* (1) 10101 (2) 10201 (3) 10202 (4) 11012
25	Choose the correct alternative that will continue the same pattern and replace the question mark in the given series. *6, 13, 25, 51, 101, ?* (1) 201 (2) 202 (3) 203 (4) 205
26	Two bus tickets from city A to B and three tickets from city A to C cost Rs. 77 but three tickets from city A to B and two tickets from city A to C cost Rs. 73. What are the fares for cities B and C from A? (1) Rs. 4, Rs. 23 (2) Rs. 13, Rs. 17 (3) Rs.15, Rs.14 (4) Rs. 17, Rs. 13
27	A pineapple costs Rs. 7 each. A watermelon costs Rs. 5 each. X spends Rs. 38 on these fruits. The number of pineapples purchased is (1) 2 (2) 3 (3) 4 (4) Data inadequate
28	A is 3 years older to B and 3 years younger to C, while B and D are twins. How many years older is C to D? (1) 2 (2) 3 (3) 6 (4) 12
29	Find the number of triangles in the given figure. (1) 12 (2) 18 (3) 22 (4) 26
30	Find the number of triangles in the given figure. (1) 21 (2) 23 (3) 25 (4) 27

StudySite.org
StudySite.org

StudySite.org
StudySite.org

31 Arrange the words given below in a meaningful sequence.
1. Poverty 2. Population 3. Death 4. Unemployment 5. Disease

(1) 2, 3, 4, 5, 1 (2) 3, 4, 2, 5, 1 (3) 2, 4, 1, 5, 3 (4) 1, 2, 3, 4, 5

32 Arrange the words given below in a meaningful sequence.
1. Probation 2. Interview 3. Selection
4. Appointment 5. Advertisement 6. Application

(1) 5, 6, 3, 2, 4, 1 (2) 5, 6, 4, 2, 3, 1
(3) 5, 6, 2, 3, 4, 1 (4) 6, 5, 4, 2, 3, 1

33 Which of the following diagrams indicates the best relation between Author, Lawyer & Singer?

(1) (2) (3) (4)



34 Choose the word that is different from the rest.

(1) Kiwi (2) Eagle (3) Emu (4) Ostrich

35 Choose the word that is different from the rest.

(1) Sparrow (2) Swan (3) Parrot (4) Koel

36 How many points will be on the face opposite to in face which contains 2 points?

(1) 1 (2) 5 (3) 4 (4) 6

37 From the four positions of a dice given below, find the color which is opposite to yellow ?

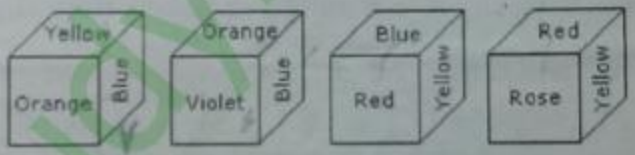

(1) Violet (2) Red (3) Rose (4) Blue

38 K is 40 m South-West of L. If M is 40 m South-East of L, then M is in which direction of K?

(1) East (2) West (3) North-East (4) South

39 Which one will replace the question mark?

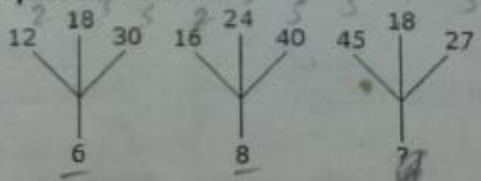

(1) 18 (2) 12 (3) 9 (4) 6

40 Which one will replace the question mark?

(1) 10 (2) 40 (3) 38 (4) 14

41 The specific resistance of a conductor depends on

(1) The material of conductor, its area of cross-section and length
(2) The area of cross-section and length of the conductor
(3) The area of cross-section of conductor only
(4) The nature of the material of conductor only

StudySite.org
StudySite.org

StudySite.org
StudySite.org

42 In the circuit shown, the point 'F' is grounded. Which of the following is a wrong statement?

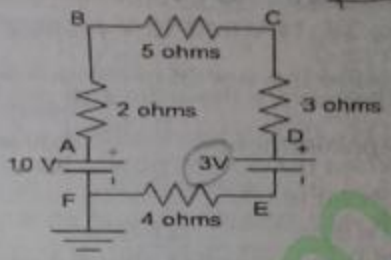

(1) D is at 5 Volts
(2) E is at zero volts
(3) The current in the circuit will be 0.5 A
(4) C is at 6.5 Volts

43 Two resistors connected in parallel across a battery of 1 V, draw a current of 1 A. When one of the resistors is disconnected, the current drawn is 0.2 A. The resistance of disconnected resistor is
(1) 1 ohm (2) 1.25 ohms (3) 2.5 ohms (4) 5 ohms

44 Point A has absolute potential of 20 volts and point B is at absolute potential of -5 volts. V_{BA} has value of
(1) -25 V (2) 15 V (3) 25 V (4) None of these

45 The direction of current flowing in the conductor shown in figure below is

(1) Towards the observer
(2) Towards left
(3) Towards right
(4) Away from the observer

46 A solenoid has resistance 'R' and inductance 'L'. This solenoid is divided into two equal parts and they are joined in parallel. The net resistance and inductance of the parallel combination will be
(1) R/2 and 2L (2) R/4 and L/2 (3) R/4 and L/4 (4) R/2 and L/4

47 The unit of flux density is
(1) Henery/m^2 (2) Webers/m^2 (3) Newton/m^2 (4) None of these

48 Two current carrying conductors, lying parallel to each other are exerting a force of repulsion on each other. The currents are
(1) Very high (2) In opposite direction (3) Low (4) In the same direction

49 For two coils with number of turns 500 and 200 each of length 1 meter and cross-sectional area 4×10^{-4} m^2, the mutual inductance is
(1) 0.5 H (2) 0.05 mH (3) 0.5 μH (4) 5 μH

50 A conducting circular loop of radius '*r*' carries current '*i*'. It is placed in a uniform magnetic field B_0 such that B_0 is magnitude of magnetic field to a plane of the loop, the magnetic force acting on the loop is
(1) $ir B_0$ (2) $2\pi ir B_0$ (3) $\pi ir B_0$ (4) Zero

51 If a current increases from zero to 1 A in 0.1 s in coil of 5 mH, then magnitude of induced *emf* is
(1) 0.005 V (2) 0.5 V (3) 0.05 V (4) 5V

52 A pure capacitance connected across 50 Hz 230 V supply consumes 0.04 W. This consumption is attributed to
(1) Ohmic loss due to ohmic resistance of plates (2) Loss of energy in dielectric
(3) Both (1) and (2) (4) The given statement is false

53 If in R-L-C series circuit, the supply current lags behind applied voltage by 60^0, then
(1) $X_L - X_c = R/\sqrt{3}$ (2) $X_L - X_c = \sqrt{3}R$ (3) $R = X_L - X_c$ (4) $X_L = X_c$

StudySite.org
StudySite.org

StudySite.org
StudySite.org

54	A series combination of resistor 'R' an inductor 'L' and a capacitor 'C' is connected across an AC source. On measurement, the voltage across 'R', 'L' and 'C' is found to be 3V, 14 V and 10 V respectively. The voltage of input source is (1) 5 V (2) 10 V (3) 27 V (4) 24 V
55	Thevenin's theorem can not be applied to networks that contain elements which are (1) Nonlinear (2) Linear (3) Active (4) Passive
56	When maximum power transfer takes place, the efficiency of the power transfer of the circuit is (1)100% (2) 75% (3) 50% (4) 25%
57	Time constant of circuit containing resistance 'R' ohms in series with an inductance of 'L' hennery is equal to (1)R x L (2) R/L (3) L/R (4) None of these
58	The conductivity of intrinsic semiconductor (1) Decreases with temperature (2) Increases with temperature (3)Remains constant with temperature (4) None of these
59	The anti ferromagnetic material is (1) Chromium (2) Copper (3) Gold (4) Bismuth
60	When the working temperature becomes more than curie temperature, the ferromagnetic material becomes (1) Diamagnetic material (2) Paramagnetic material (3) Ferrimagnetic material (4) Ferromagnetic material
61	In p-type semiconductor, the majority carriers of current are (1) Holes (2) Electrons (3) Protons (4) Neutrons
62	Depletion layer consists of (1) Electrons (2) Immobile ions (3) Holes only (4) Both (1) and (3)
63	If the forward voltage in a diode is increased, the width of depletion region (1) Fluctuates (2) Decreases (3) Increases (4) Does not fluctuate
64	Reverse bias applied to a junction diode (1)Raises the potential barrier (2) Increases the majority carriers of current (3)Lower the potential barrier (4) Increases the minority carriers of current
65	In the circuit shown in figure, the transistor used has a current gain β = 100. What should be the bias resister R_B so that V_{CE} =5 V. Neglect V_{BE} (1)200 x 10^3 ohms (2)10^6 ohms (3)500 ohms (4)2000 ohms 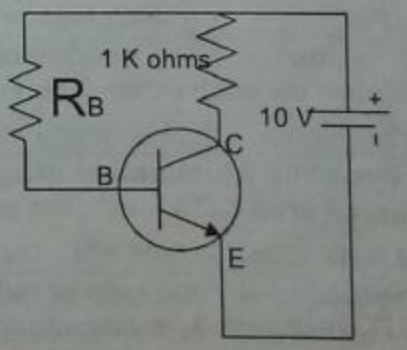
66	A thyristor can be fabricated using (1)Silicon (2) Germanium (3) Gallium arsenide (4) Any semiconducting material
67	The data sheet of a certain unijunction transistor (UJT) gives efficiency η = 0.7. If the total voltage across the two bases is 20 V and diode drop is 0.7 Volts, then peak point emitter voltage in Volts will be (1)13.3 (2) 14.0 (3) 14.7 (4) 15.4
68	In case of MOSFET, when the drain current in the constant current region increases then (1) The gate to source voltage increases (2)The gate to source voltage decreases (3)The drain to source voltage decreases (4) The drain to source voltage increases

StudySite.org
StudySite.org

StudySite.org StudySite.org

69	**A resistance connected in series with an LED in a circuit application is required in order to** (1) Restrict current (2) Restrict the voltage across LED (3) Decrease the power dissipation (4) Improve power factor
70	**In liquid crystal diode (LCD), the function of the polarizer is to remove** (1) Horizontal component of light only (2) Vertical component of light only (3) Either (1) or (2) (4) Both (1) and (2)
71	**Which of the following does not constitute a part of the eddy current damping?** (1) Coil (2) Aluminium frame (3) Aluminium piston (4) Aluminium disc
72	**As per the Indian Electricity Rules, which of the following is a permissible range of frequency variation** (1) ±3% (2) ±5% (3) ±7% (4) ±9%
73	**Which of the following is an essential system of a measuring instrument working on the principles of magnetic and electromagnetic induction?** (1) Moving mechanism (2) Controlling system (3) Damping system (4) All of these
74	**A constant current of 2.8 Ampere exists in a resistor. The rms value of current is** (1) 2.8 A (2) About 2 A (3) 1.4 A (4) Undefined
75	**An alternating current is represented as $i = 70.7\sin(520t + \frac{\pi}{6})$. The frequency and rms value of the current are** (1) 82.76 Hz, 50 A (2) 41.38 Hz, 25 A (3) 41.38 Hz, 50 A (4) 82.76 Hz, 25 A
76	**Two sinusoidal emfs are given by $e_1 = A\sin(wt + \frac{\pi}{4})$ & $e_2 = B\sin(wt - \frac{\pi}{6})$. The phase difference between quantities in degrees is** (1) 75^0 (2) 105^0 (3) 60^0 (4) 15^0
77	**Which of the following can not be used for measuring both alternating & direct quantities?** (1) Moving coil permanent magnet type (2) Moving coil dynamometer type (3) Moving iron type (4) Hot wire type
78	**Which of the following is an appropriate description of a shunt resistance?** (1) Low resistance connected in parallel with the ammeter (2) High resistance connected in parallel with the ammeter (3) Low resistance connected in series with the ammeter (4) High resistance connected in series with the ammeter
79	**In the method of measuring power in a three phase circuit by two wattmeter method, one of the wattmeter indicates a negative reading. What should be done to read the wattmeter reading correctly?** (1) Reverse the connections of the current coil of the wattmeter showing positive reading (2) Reverse the connections of the current coil of the wattmeter showing negative reading (3) Reverse the connections of the pressure coil of the wattmeter showing positive reading (4) Reverse the connections of the pressure coil of the wattmeter showing negative reading
80	**The repulsion start induction-run motor is used because of** (1) High efficiency (2) High starting torque (3) Minimum cost (4) Good power factor
81	**Which of the following has highest starting torque?** (1) Split-phase motor (2) Shaded pole motor (3) Capacitor start motor (4) Repulsion motor
82	**If in a transformer the secondary turns are doubled and at the same time the primary voltage is reduced by half, then secondary voltage will** (1) be Halved (2) be four times as high (3) Not change (4) be Reduced to a quarter
83	**According to the name plate of a small transformer, the secondary normal voltage is 220 volts. Which of the following statements about it is true?** (1) The no load voltage is more than 220 volts (2) 220 V is the no load voltage (3) At a load which draws the rated current, the voltage becomes less than 220 V (4) The secondary voltage increases with increasing load.

StudySite.org StudySite.org

StudySite.org
StudySite.org

84	**The two transformers are operating in parallel. They will share the load depending upon their** (1) Efficiency (2) Ratings (3) Leakage reactance (4) Per unit impedance
85	**The armature resistance of a 220 V DC shunt motor is 0.4 ohms and no load armature current is 2 Ampere. The no loads speed would be** (1) 1200 RPM (2) 1330 RPM (3) 1460 RPM (4) 1500 RPM
86	**The current delivered by a four pole DC shunt generator is 98 Ampere. The shunt field current is 2 Ampere. The armature is lap wound. The current per parallel path is** (1) 12.5 A (2) 50 A (3) 25 A (4) 100 A
87	**The power stated on name plate of any motor is always** (1) The output power at the shaft (2) The power drawn in KVA (3) The power drawn in kW (4) The gross power
88	**A four pole lap wound armature has 480 conductors and a flux per pole of 25 mWb. The emf generated when running at 600 RPM will be** (1) 240 V (2) 120 V (3) 60 V (4) 30 V
89	**When substance is placed in magnetic field, its ability to get magnetized depends upon its** (1) Susceptibility (2) Permittivity (3) Permeability (4) None of these
90	**An induction motor has a rated speed of 715 RPM. How many poles has its rotating magnetic field?** (1) 2 poles (2) 4 poles (3) 6 poles (4) 8 poles
91	**A three phase induction motor is running at a load of rated torque. What happens when one of the outer mains is interrupted while the motor is running?** (1) The motor stops immediately (2) The motor stops after a few seconds (3) The motor keeps running but draws more current (4) The motor keeps running but draws less current
92	**The power factor of an induction motor at low loads is low due to** (1) High working component of I_0 (2) High magnetizing component of I_0 (3) High speed (4) Low magnetizing component of I_0
93	**In an induction motor the rotor input is 600 Watts and slip is 4%. The rotor copper loss is** (1) 700 Watts (2) 0.6 Watts (3) 650 Watts (4) 24 Watts
94	**Which following statement is true for an induction motor?** (1) If (1-s) is power input to the rotor, the power lost in the rotor is s(1-s) (2) The maximum torque of an induction motor is independent of the rotor resistance (3) An induction motor can supply the load stably from s = 0 to s = R_2/X_2 (4) The efficiency of an induction motor is maximum when $R_2 = X_2$
95	**The shape of the torque-slip characteristics of an induction motor is** (1) Rectangular hyperbola (2) Straight line (3) Parabola (4) Hyperbola
96	**The slip rings employed in three phase alternator in hydro station are insulated for** (1) Full armature voltage (2) Extra high voltage (3) Low voltage (4) Very high voltage
97	**The diameters of high speed turbo alternators as compared to hydroelectric ones are** (1) Smaller because speed is less (2) Larger because speed is high (3) Smaller because speed is high (4) None of these
98	**The working of synchronous motor is similar to** (1) Distribution transformer (2) Turbine (3) Gear train arrangement (4) The transmission of mechanical power by shaft
99	**The maximum power developed in a synchronous motor occurs at a coupling angle of** (1) 0^0 (2) 40^0 (3) 90^0 (4) 180^0
100	**A synchronous machine with a large air gap has** (1) A small value of inherent regulation (2) A higher value of stability limit (3) A higher synchronizing power which makes the machine less sensitive to load variation (4) All of these

StudySite.org
StudySite.org

StudySite.org

PSTCL REVISED ANSWER KEYS

Q. NO	Asstt. Mgr. (HR)				UDC General				UDC Accounts				Asstt. Mgr. (IT)				AE Electrical				AE Civil				JE Electrical				JE Civil				Accounts Officer				Accountant				SSA				Electrician Gr-II				Law Officer		Draftsman (Civil)		Draftsman (Electrical)
	KEY Set A	KEY Set B	KEY Set C	KEY Set D	Key Set A	Key Set B	Key Set C	Key Set D	Key Set A	Key Set B	Key Set C	Key Set D	Key Set A	Key Set B	Key Set C	Key Set D	Key Set A	Key Set B	Key Set C	Key Set D	Key Set A	Key Set B	Key Set C	Key Set D	Key Set A	Key Set B	Key Set C	Key Set D	Key Set A	Key Set B	Key Set C	Key Set D	Key Set A	Key Set B	Key Set C	Key Set D	Key Set A	Key Set B	Key Set C	Key Set D	Key Set A	Key Set B	Key Set C	Key Set D	Key Set A	Key Set B	Key Set A	Key Set B	Key Set A
1	4	4	4	2	1	0	1	3	4	4	1	2	3	3	1	2	4	2	2	2	4	1	4	1	3	3	3	4	2	3	3	2	2	1	4	1	2	2	2	4	4	2	4	1	1	3	2	4	1	4	2	4	3
2	2	2	2	2	2	2	4	1	3	4	2	1	3	3	2	1	2	2	1	3	2	3	1	2	2	3	1	2	3	4	4	2	2	2	2	3	3	3	4	3	0	4	1	4	1	3	4	4	3	2	4	3
3	2	4	4	4	3	2	3	2	4	2	2	2	2	2	2	3	3	1	1	4	1	4	2	4	2	4	3	2	3	3	3	2	3	3	3	3	1	3	2	3	2	2	2	2	3	4	1	2	3	4	x	2	2
4	4	2	4	4	3	3	0	1	1	4	3	2	4	4	3	2	1	3	2	2	3	1	1	4	1	2	3	3	2	1	3	3	1	1	1	2	4	2	2	3	1	4	2	4	2	3	3	1	4	3	2	3	4
5	4	3	4	4	1	1	2	4	4	2	1	4	1	2	3	2	2	2	2	2	4	4	3	3	3	3	2	2	3	3	4	2	4	2	2	2	2	3	3	2	2	4	0	2	2	1	1	3	3	4	3	4	2
6	2	2	4	2	1	3	2	3	4	1	4	3	3	2	2	4	4	1	1	3	3	2	4	4	1	3	4	1	3	3	3	2	2	3	3	4	1	2	3	4	1	2	2	4		1	4	2	4	3	4	4	1
7	4	2	2	2	3	4	3	3	3	2	4	2	2	2	4	1	2	1	3	1	1	1	1	3	4	1	2	2	2	4	1	4	1	2	1	2	4	3	3	2	3	2	4	4	4	2	3	3	3	4	3	2	4
8	2	2	2	0	4	1	1	3	4	4	3	4	2	1	2	2	2	2	2	1	4	4	4	2	3	3	3	3	3	3	3	3	4	4	2	3	3	2	3	2	3	4	4	2	2	2	1	1	4	1	2	3	X
9	2	2	2	4	2	1	2	3	4	2	1	3	2	3	3	2	3	4	2	3	4	4	2	1	2	3	2	2	1	2	3	3	3	2	2	3	4	2	3	1	1	1	3	2	4	1	2	3	1	4	3	2	X
10	2	2	2	4	4	3	3	1	2	4	4	4	2	2	2	3	1	3	2	4	1	3	1	4	1	1	4	3	4	1	2	2	2	2	1	2	3	1	4	2	1	1	1	1	4	4	4	1	4	3	2	2	4
11	1	4	2	1	2	4	3	2	3	3	2		2	2	4	2	2	2	2	3	1	3	3	4	1	2	4	2	4	2	3	1	2	2	1	3	4	2	4	4	4	2	2	2	3	3	1	2	4	3	4	3	4
12	0	2	3	1	3	4	2	2	4	3	4	3	1	2	1	2	4	4	2	2	3	1	1	1	3	3	4	4	4	3	2	1	4	4	3	x	3	3	2	x	1	3	2	4	4	2	1	1	1	4	3	4
13	2	4	1	3	1	1	3	2	4	4	3	2	2	1	1	1	3	4	1	3	3	2	3	1	4	3	2	1	2	4	4	2	x	1	2	2	x	2	3	3	2	2	4	2	2	1	3	1	1	2	2	2	2	2
14	2	4	2	1	2	4	3	3	2	3	2	3	2	2	3	2	2	2	3	1	1	4	1	1	4	3	3	3	1	3	3	1	x	4	1	2	x	3	3	2	2	3	1	1	1	3			4	2	2	2	2	4
15	2	2	4	2	3	3	3	2	1	4	4	2	2	2	4	3	1	3	3	4	2	1	4	2	3	2	1	3	3	3	2	4	3	3	4	1	2	1	4	4	4	2	4	3	3	3	2	2	3	4	4	x	2
16	4	2	2	2	3	3	1	3	2	3	2	2	4	1	1	2	2	4	4	4	3	3	2	4	4	3	3	4	3	4	4	2	1	4	1	1	4	3	3	2	4	1	2	3	2	2	1	4	2	3	1	4	1
17	4	1	1	0	2	3	2	2	4	3	3	1	1	1	2	3	3	2	2	3	1	3	1	0	1	1	1	3	2	1	4	3	2	2	2	2	3	3	4	1	1	1	1	1	1	4	4	2	2	2	3	4	x
18	3	2	2	4	1	4	1	2	4	2	4	4	1	4	3	3	3	4	4	2	2	1	4	3	2	2	2	3	3	2	2	2	4	2	2	2	4	1	2	3	2	3	1	0	2	3	1	0	4	4	1	1	x
19	2	2	2	2	2	3	1	1	3	3	3	4	4	4	2	1	1	3	3	4	3	4	3	2	3	1	4	3	2	2	2	4	2	4	x	1	4	4	x	2	1	4	3	2	4	2	1	1	1	3	4	4	3
20	2	2	2	3	0	1	1	2	4	3	4	3	3	3	1	4	2	4	3	1	1	3	2	3	3	1	2	3	3	3	2	2	1	2	2	2	2	1	4	4	2	3	1	2	3	4	4	3	2	2	4	4	4
21	1	2	0	2	2	2	4	3	3	4	1	4	1	2	2	4	2	3	4	2	1	4	1	3	4	2	3	4	2	1	3	3	3	3	4	1	2	4	3	4	0	2	3	2	1	2	2	1	1	2	2	3	2
22	2	2	2	2	3	2	4	2	4	2	4	4	1	2	4	2	2	2	4	2	3	1	1	1	1	4	2	1	1	1	2	4	2	x	2	2	3	x	1	4	2	4	3	1	4	1	1	4	4	2	4	2	2
23	3	2	2	2	1	2	1	1	3	2	4	3	1	1	3	1	4	3	3	2	2	1	4	4	3	1	3	3	4	2	3	3	1	2	2	4	2	3	3	2	3	2	1	4	4	1	3	2	2	3	2	3	3
24	2	0	2	2	3	2	4	2	2	1	4	4	2	3	2	3	1	4	2	2	1	2	3	2	2	3	3	2	2	1	4	2	3	2	2	2	2	4	2	3	2	3	3	3	3	2	3	2	3	3	3	1	x
25	4	0	4	4	2	3	3	4	3	4	3	3	3	2	1	2	2	4	2	1	3	4	1	1	4	2	1	4	2	1	2	2	3	2	2	3	3	4	3	1	4	1	4	3	1	4	4	3	2	4	4	1	3
26	2	1	2	2	3	2	2	1	2		4	3	1	4	2	2	1	1	2	3	3	3	1	3	2	3	4	4	4	2	1	2	2	2	x	x	3	4	x	x	2	2	4	3	1	3	1	1	2	3	1	4	2
27	3	2	2	4	2	2	2	0	2	4	3	4	3	2	2	3	3	2	3	2	0	1	4	1	3	1	2	3	3	4	1	3	2	2	3	1	1	4	4	2	1	1	2	2	4	4	2	3	2	2	3	4	1
28	4	4	2	4	4	2	3	2	4	4	2	3	2	3	4	2	4	2	1	1	1	2	3	4	1	2	3	4	3	3	2	3	4	2	1	3	3	3	4	3	3	3	2	2	3	2	2	4	4	1	3	2	1
29	1	2	2	2	2	1	3	3	4	4	3	4	3	2	2	4	4	3	1	1	4	3	1	1	2	4	3	2	2	2	1	1	3	x	2	1	3	3	x	2	1	3	1	4	3	1	4	3	2	1	2	2	2
30	2	4	4	1	2	3	2	3	4	1	4	4	2	2	3	2	1	2	4	3	4	1	4	3	4	4	2	1	3	2	2	1	3	1	3	2	3	4	3	1	3	1	2	1	4	4	2	4	4	4	2	3	2
31	2	2	0	2	3	1	3	4	1	1	4	4	3	1	2	2	3	3	4	4	1	2	4	1	3	2	4	3	3	2	2	3	1	2	1	4	3	4	2	3	3	1	3	3	1	4	4	2	4	2	3	1	1
32	4	1	3	2	2	2	2	3	1	3	3	4	3	3	4	1	4	3	1	2	2	0	1	3	3	3	3	1	4	3	2	1	1	2	2	2	4	1	4	3	2	1	2	1	1	2	3	4	3	3	3	3	2
33	2	3	1	2	4	1	3	4	3	3		3	2	3	1	2	2	3	4	4	3	4	4	2	3	3	3	2	3	4	3	2	2	4	4	2	2	3	3	3	4	1	1	3	3	3	2	3	2	3	2	2	3	2
34	4	4	3	2	4	3	3	2	2	1	2	2	4	1	2	1	4	1	3	2	1	3	1	1	2	2	2	4	2	4	3	2	2	2	3	3	1	3	3	1	2	4	2	2	1	3	3	1	4	1	x	1	4
35	2	4	2	3	3	3	1	3	2	3	4	4	4	2	3	3	3	1	4	3	1	1	3	1	2	3	1	3	1	1	3	3	1	2	2	1	2	2	1	3	2	1	3	1	1	4	4		2	2	3	1	4
36	2	1	4	2	3	3	4	4	3	4	4	4	2	4	2	4	4	2	2	4	4	3	4	1	4	4	3	2	2	1	3	2	1	1	4	2	2	4	3	1	1	2	3	3	4	1	3	2	4	4	1	1	2
37	2	2	4	2	3	3	2	1	4	4	2	1	4	4	1	3	3	1	3	3	4	3	1	4	1	1	1	3	2	2	2	3	4	1	2	2	4	4	3	3	3	2	2	1	2	2	1	3	3	4	4	2	1

StudySite.org

StudySite.org
StudySite.org

PSTCL REVISED ANSWER KEYS

Q. NO	Asstt. Mgr. (HR)				UDC General				UDC Accounts				Asstt. Mgr. (IT)				AE Electrical				AE Civil				JE Electrical				JE Civil				Accounts Officer				Accountant				SSA				Electrician Gr-II				Law Officer		Draftsman (Civil)		Draftsman (Electrical)
	KEY Set A	KEY Set B	KEY Set C	KEY Set D	Key Set A	Key Set B	Key Set C	Key Set D	Key Set A	Key Set B	Key Set C	Key Set D	Key Set A	Key Set B	Key Set C	Key Set D	Key Set A	Key Set B	Key Set C	Key Set D	Key Set A	Key Set B	Key Set C	Key Set D	Key Set A	Key Set B	Key Set C	Key Set D	Key Set A	Key Set B	Key Set C	Key Set D	Key Set A	Key Set B	Key Set C	Key Set D	Key Set A	Key Set B	Key Set C	Key Set D	Key Set A	Key Set B	Key Set C	Key Set D	Key Set A	Key Set B	Key Set C	Key Set D	Key Set A	Key Set B	Key Set A	Key Set B	Key Set A
38	4	4	1	4	3	2	2	3	3	2	4	1	2	1	3	1	3	2	3	4	3	1	0	3	1	4	3	3	1	2	3	4	2	3	2	4	1	2	1	3	4	2	1	1	2	1	2	2	3	1	2	2	2
39	1	4	4	4	1	3	2	1		4	3	1	3	3	3	3	3	3	4	4	4	1	2	3	3	3	3	1	3	3	4	3	2	1	1	2	3	3	4	1	3	1	3	3	3		2	4	3	2	3	3	4
40	0	3	2	2	1	2	3	3	1	4	1	4	2	3	2	4	2	4	3	1	4	4	3	3	3	2	1	1	3	2	1	2	2	3	2	1	3	3	1	4	1	2	1	2	2	2	4	2	3	4	4	2	1
41	4	4	2	2	4	3	4	4	3	4	2	3	4	1	4	4	2	3	3	4	2	2	2	1	4	1	0	2	1	3	3	3	2	3	1	4	1	1	1	2	3	3	3	4	3	1	2	1	3	1	1	4	3
42	2	2	3	3	3	2	2	2	1	2	3	1	1	1	4	2	1	3	2	1	3	3	3	3	2	1	4	2	4	2	2	4	3	4	4	2	2	1	4	3	1	3	2	4	2	3	2	1	1	1	4	4
43	3	2	3	1	1	3	3	4	3	4	1	1	3	3	1	3	1	3	2	1	2	2	2	2	2	2	1	3	2	3	4	1	3	1	1	2	4	1	1	2	3	1	4	3	1	4	1	2	1	1	4	3	2
44	3	4	2	4	2	4	3	4	1	1	1	1	2	2	3	1	2	2	4	4	2	3	2	2	1	3	1	2	1	3	1	4	4	3	1	2	3	3	2	1	2	2	2	2	2	2	2	1	4	3	1	1	1
45	3	1	1	3	4	1	4	3	1	1	3	1	3	3	3	3	3	3	3	3	4	1	2	2	4	1	3	2	X	3	3	3	4	3	4	1	3	4	3	1	0	1	4	1	2	2	1	4	4	1	1	2	3
46	2	1	3	2	1	2	3	4	3	1	1	2	2	3	2	2	2	3	4	2	2	3	2	2	3	3	1	3	1	2	1	3	3	1	1	3	3	2	2	4	4	3	2	2	1	3	3	2	3	1	2	4	4
47	4	3	4	1	3	4	4	3	1	4	2	3	2	3	2	1	1	1	2	4	4	2	3	3	2	3	3	1	4	1	3	4	4	2	3	3	1	2	2	3	2	3	2	3	3	2	2	2	3	2	3	2	1
48	4	1	1	2	4	2	3	3	1	2	3	1	4	1	3	1	4	2	3	3	1	4	2	4	2	1	2	1	3	2	2	3	3	4	2	1	2	2	3	1	1	2	3	1	0	2	1	4	2	1	1	3	3
49	1	4	3	3	3	1	1	4	3	1	2	2	3	2	3	1	3	1	1	4	3	3	2	2	2	1	2	1	4	2	1	3	2	2	3	1	3	2	2	3	2	1	1	1	1	1	4	1	1	3	4	1	3
50	4	4	3	3	3	4	4	1	4	1	2	1	4	1	3	2	4	4	1	2	1	2	2	1	3	2	3	2	1	4	1	3	3	2	2	2	3	2	2	2	0	2	3	3	2	1	2	2	2	1	3	4	2
51	3	3	3	4	2	3	2	2	1	2	4	4	3	2	1	4	4	1	2	1	3	4	4	2	3	2	1	3	1	1	2	4	2	1	2	2	4	4	3	4	1	3	3	3	1	1	1	2	1	4	4	4	2
52	3	4	1	3	1	3	4	3	1	1	3	2	3	1	4	1	2	3	4	2	4	3	1	2	3	1	2	1	4	4	3	4	4	3	4	1	2	3	2	1	1	1	3	3	3	2	2	4	4	3	2	1	1
53	3	3	3	4	2	3	2	2	3	1	1	3	2	1	2	4	1	2	2	3	3	1	2	4	2	3	1	1	2	4	1	3	4	2	4	1	4	3	3	2	4	1	3	3	4	1	3	2	2	2	3	3	2
54	3	1	3	4	3	3	2	4	1	1	3	4	3	1	1	4	2	3	3	2	3	4	3	3	1	1	1	3	1	3	2	3	1	2	3	4	1	1	2	1	4	0	1	1	1	2	2	2	1	1	3	2	3
55	2	3	1	1	2	4	4	1	2	3	1	2	1	1	3	3	2	3	3	1	4	1	4	3	1	4	1	2	2	3	4	1	2	1	2	3	3	4	4	3	4	1	1	2	4	2	1	1	1	4	2	4	1
56	1	3	1	3	3	4	3	2	4	3	1	3	1	4	1	1	2	2	4	2	1	3	3	4	3	3	1	1	4	3	4	2	2	4	3	2	3	1	1	3	3	1	3	3	1	2	2	1	1	1	3	1	1
57	3	3	1	3	4	1	3	3	4	3	2	3	3	3	1	2	1	3	3	4	2	2	4	2	3	1	1	3	1	3	3	1	2	3	2	1	2	2	3	1	2	3	3	0	2	1	2	2	3	1	4	2	4	2
58	4	1	3	3	1	3	1	2	3	1	3	1	3	2	2	2	1	4	2	4	3	2	1	2	3	2	3	1	1	1	3	4	3	1	2	2	3	2	2	3	2	2	3	1	1	3	2	2	1	3	3	1	2
59	1	4	1	2	2	3	2	1	2	4	3	2	3	3	4	3	3	1	1	2	3	1	2	2	1	4	3	3	2	3	4	3	1	2	2	3	2	4	4	1	1	3	3	3	1	4	3	2	1	4	3	4	4
60	3	3	3	2	4	1	3	3	2	1	3	3	1	2	1	4	4	2	3	0	2	1	1	4	2	2	3	1	4	3	2	3	2	2	2	1	1	2	2	2	4	1	3	3	4	1	2	2	3	1	3	4	3
61	3	4	4	2	1	3	2	1	1	2	3	4	3	3	2	4	3	1	4	0	1	3	1	3	1	1	4	2	3	2	3	1	3	3	3	1	4	3	3	3	3	3	1	2	1	1	1	3	2	1	2	2	4
62	3	1	1	4	3	4	2	3	3	1	1	2	2	3	4	1	1	3	1	1	4	4	4	1	2	1	1	2	1	4	1	4	1	2	2	4	4	4	2	3	3	1	3	3	2	1	1	4	2	1	4	4	1
63	1	2	2	1	3	3	3	2	1	1	4	3	3	1	4	2	3	4	3	3	2	3	3	2	2	1	3	3	3	4	2	3	1	3	1	1	1	3	3	1	1	3	1	1	2	2	1	3	4	1	1	3	3
64	4	1	4	3	3	2	1	2	2	4	1	4	1	2	4	4	3	4	0	2	3	3	3	3	1	1	2	4	4	4	1	2	3	3	1	4	3	3	3	1	1	3	1	2	3	1	1	3	3	1	3	1	4
65	2	3	3	1	3	2	4	4	3	3	3	3	1	4	1	3	3	3	3	3	2	4	1	4	1	1	4	1	3	3	3	4	3	1	1	2	1	2	2	4	4	1	3	4	1	4	4	4	2	2	2	1	2
66	1	2	3	3	2	1	3	3	3	4	3	4	1	3	3	1	3	4	1	1	3	2	1	2	1	4	4	1	2	1	3	3	3	2	2	3	2	3	4	4	1	1	3	3	1	4	4	4	2	1	3	1	1
67	1	2	4	3	4	3	4	2	4	4	4	1	2	1	4	3	2	2	2	3	3	2	3	3	3	1	3	1	3	4	3	2	3	1	4	1	2	1	1	2	3	4	1	3	2	1	2	3	1	1	1	1	1
68	2	4	3	4	1	3	3	3	3	4	2	1	3	1	1	1	3	3	3	2	2	1	3	1	1	3	1	3	3	2	4	4	3	3	3	2	3	2	3	3	3	3	2	1	3	2	2	1	1	1	4	2	3
69	3	3	3	2	4	1	1	3	2	2	3	1	3	3	3	3	3	2	3	2	4	2	1	3	1	3	1	1	4	3	3	1	2	3	3	1	4	1	4	1	4	4	1	3	1	2	2	1	1	1	4	4	1
70	3	2	3	4	4	3	1	3	1	3	4	4	4	3	3	4	2	4	1	4	3	2	3	1	3	1	2	3	3	1	1	1	4	1	3	3	1	1	3	3	3	2	2	3	2	2	1	3	1	1	4	4	4
71	1	1	1	1	3	2	2	4	1	1	4	1	2	4	2	3	4	2	2	3	2	3	3	4	3	4	2	4	1	2	2	X	1	4	4	4	2	1	4	3	3	2	4	2	3	2	1	1	2	1	2	3	3
72	1	2	4	3	3	1	3	4	2	2	3	4	1	4	2	4	4	0	1	2	3	3	4	2	1	2	2	4	4	1	4	1	3	1	4	2	3	3	1	1	1	2	4	3	1	3	3	4	1	1	3	4	4
73	1	1	4	3	3	2	3	1	3	3	4	4	3	4	1	3	1	1	1	2	1	2	3	4	4	3	2	3	3	4	1	4	3	2	2	4	4	4	4	2	2	3	1	0	2	2	2	2	1	4	4	1	2
74	4	4	2	4	3	3	1	1	4	1	4	4	1	1	2	3	3	1	2	3	4	1	2	1	1	2	3	1	3	4	1	3	2	4	3	3	1	3	3	4	2	2	1	1	3	3	1	2	4	4	2	3	3

StudySite.org
StudySite.org

StudySite.org
StudySite.org

PSTCL REVISED ANSWER KEYS

Q. NO	Asstt. Mgr. (HR)				UDC General				UDC Accounts				Asstt. Mgr. (IT)				AE Electrical				AE Civil				JE Electrical				JE Civil				Accounts Officer				Accountant				SSA				Electrician Gr-II				Law Officer		Draftsman (Civil)		Draftsman (Electrical)
	KEY Set A	KEY Set B	KEY Set C	KEY Set D	Key Set A	Key Set B	Key Set C	Key Set D	Key Set A	Key Set B	Key Set C	Key Set D	Key Set A	Key Set B	Key Set C	Key Set D	Key Set A	Key Set B	Key Set C	Key Set D	Key Set A	Key Set B	Key Set C	Key Set D	Key Set A	Key Set B	Key Set C	Key Set D	Key Set A	Key Set B	Key Set C	Key Set D	Key Set A	Key Set B	Key Set C	Key Set D	Key Set A	Key Set B	Key Set C	Key Set D	Key Set A	Key Set B	Key Set C	Key Set D	Key Set A	Key Set B	Key Set C	Key Set D	Key Set A	Key Set B	Key Set A	Key Set B	Key Set A
75	2	4	1	3	2	2	2	2	4	3	4	4	2	2	3	1	4	3	4	3	1	2	3	3	1	3	3	1	2	3	1	2	1	2	3	1	1	1	4	2	4	1	3	1	1	3	1	2	2	4	4	1	3
76	4	3	3	3	3	3	3	3	3	3	1	1	3	4	1	3	1	0	2	1	3	4	1	1	1	1	3	4	2	3	4	3	3	1	2	2	3	4	3	4	1	4	1	3	3	3	1	3	2	4	2	1	2
77	1	1	3	3	2	2	2	4	2	2	1	1	4	4	3	1	3	1	3	3	4	4	3	1	1	1	4	3	1	2	3	1	2	1	1	2	2	2	4	3	3	3	4	2	2	3	2	1	2	4	2	1	1
78	1	3	1	1	2	2	3	1	4	1	4	2	2	4	2	3	4	2	1	4	3	4	4	2	1	4	2	4	4	1	1	1	3	1	1	2	3	4	4	3	4	2	3	1	1	3	1	1	4	3	1	1	2
79	4	2	2	2	4	2	3	4	4	4	4	3	1	2	1	4	3	4	3	3	1	4	2	2	4	4	1	0	3	4	3	3	1	3	3	1	4	2	1	1	1	2	3	3	4	1	1	2	1	2	4	3	4
80	2	4	4	2	1	3	1	3	2	3	4	1	2	4	3	4	2	3	3	3	1	3	2	3	2	3	1	3	3	2	3	2	2	1	3	1	2	1	3	1	4	1	3	1	3	1	2	1	4	4	3	4	3
81	3	3	3	2	1	4	2	3	4	2	2	2	3	4	2	3	2	3	4	4	2	2	1	2	3	0	1	1	3	3	2	1	3	1	2	1	1	1	1	1	3	3	3	2	2	2	2	2	1	3	1	2	1
82	2	4	2	2	2	4	2	3	4	3	3	1	4	1	2	1	1	1	4	3	2	2	3	3	3	1	1	1	4	3	4	4	2	2	3	3	4	1	3	3	3	1	1	2	1	2	1	2	1	4	1	4	4
83	4	1	1	3	1	1	4	3	3	3	3	3	3	3	1	2	4	3	1	1	2	1	3	4	1	0	3	2	1	4	3	1	2	2	3	1	3	3	2	4	1	3	4	3	1	1	4	1	4	4	3	4	3
84	1	1	4	2	3	2	3	1	2	3	1	3	4	2	1	2	0	1	1	2	4	3	1	2	4	2	2	3	3	2	4	1	1	4	4	3	4	4	3	3	3	2	2	1	3	2	3	1	4	2	1	2	2
85	3	3	2	4	1	2	2	1	3	3	1	1	3	3	2	3	3	4	3	1	1	3	2	2	0	3	3	2	4	1	3	2	2	2	1	3	3	4	1	4	3	3	1	4	1	1	3	1	4	2	4	4	4
86	4	2	2	4	4	1	2	1	1	4	4	3	1	2	2	3	1	1	4	3	3	3	4	2	3	2	4	1	3	2	4	3	3	1	3	3	2	1	2	3	3	3	2	3	3	1	1	2	2	1	3	4	1
87	2	2	2	1	3	2	1	2	1	1	1	4	1	2	3	2	2	2	3	4	2	2	1	1	1	1	0	1	4	1	4	2	2	1	4	2	2	1	3	3	1	2	3	3	3	2	3	1	2	4	2	1	1
88	3	2	2	3	1	4	2	3	3	3	1	4	4	4	4	1	0	2	3	3	3	2	4	1	2	4	1	3	1	1	3	2	1	2	1	1	3	1	2	2	1	3	3	3	2	4	2	2	4	3	2	1	1
89	3	3	4	3	3	1	3	2	4	4	1	1	3	3	4	2	4	2	4	4	2	4	1	1	1	3	3	4	1	4	1	3	1	4	3	3	1	2	3	3	1	0	3	1	1	2	3	1	1	1	4	3	2
90	3	3	2	1	2	2	1	3	1	1	1	1	4	2	3	1	2	4	1	1	3	1	2	3	4	3	2	2	2	2	2	4	4	2	3	4	1	1	4	2	4	3	4	1	2	2	1	2	1	1	3	4	4
91	2	3	4	1	3	4	3	2	3	4	1	1	1	1	3	2	3	1	2	2	1	3	3	2	3	1	1	1	2	3	1	1	1	3	1	4	2	2	1	3	1	4	3	3	2	4	1	3	1	4	2	3	3
92	4	4	4	4	3	3	3	2	4	3	2	2	1	1	4	3	1	1	0	4	1	3	4	3	2	2	1	3	4	4	3	1	4	4	1	2	3	2	4	4	3	1	4	3	1	2	2	3	1	1	3	1	2
93	3	2	3	1	2	1	2	4	1	4	2	3	2	2	4	1	4	2	2	1	1	2	4	3	4	3	4	3	3	1	1	3	3	3	1	3	3	3	4	2	2	1	2	4	1	1	3	4	2	1	4	3	2
94	2	3	2	1	4	3	1	2	4	1	1	3	4	4	3	4	3	4	4	1	2	1	2	4	0	3	4	1	3	1	1	1	1	3	2	2	1	3	3	2	3	3	1	3	1	3	1	3	2	1	2	3	1
95	4	3	2	4	2	3	3	4	4	1	3	4	4	3	3	1	1	2	1	1	4	3	3	2	1	1	1	3	1	1	2	3	2	1	3	2	2	1	3	1	3	3	3	1	2	1	1	2	1	1	2	3	1
96	1	3	1	2	2	2	1	1	1	3	4	4	2	2	3	3	3	4	2	3	2	1	4	3	1	4	3	0	3	3	4	4	1	3	4	2	1	3	2	3	2	1	0	3	3	1	2	1	1	2	1	3	3
97	2	2	4	1	3	4	1	3	4	3	3	2	4	4	2	2	3	4	4	1	3	1	3	4	3	2	2	2	2	3	2	4	1	4	1	4	1	2	2	1	2	4	3	4	1	1	1	4	1	1	4	3	4
98	3	3	3	3	2	4	4	2	3	1	1	3	4	3	4	2	2	3	2	4	4	4	2	4	4	4	4	4	1	X	1	4	1	4	2	3	4	3	3	1	2	3	4	3	2	2	1	4	1	1	3	4	1
99	2	1	2	2	4	1	4	2	1	4	4	4	1	3	1	4	1	1	1	2	2	2	2	4	3	2	3	4	3	2	3	1	1	2	3	2	1	1	4	1	4	1	2	3	1	4	1	1	4	4	4	4	4
100	2	2	4	4	2	3	1	1	3	4	4	3	2	2	3	2	4	1	2	1	4	4	4	3	4	2	4	2	4	4	X	2	3	4	3	1	2	1	1	1	2	4	4	3	1	4	1	1	4	3	3	3	4

StudySite.org
StudySite.org